Adding Decimals Using Number Lines

Complete each addition sentence using the number line.

1)

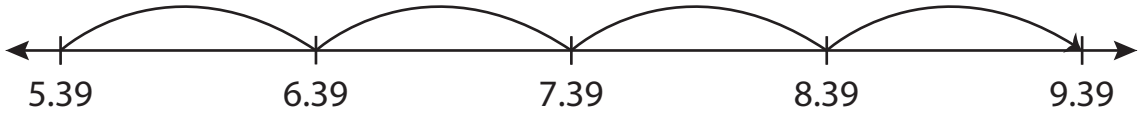

5.39 + 4 = _____

2)

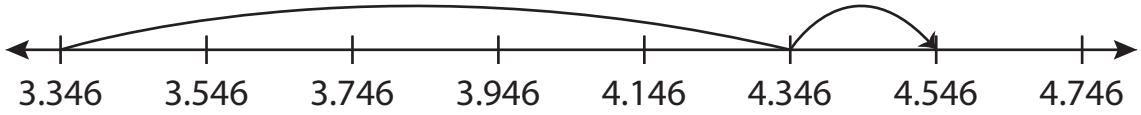

3.346 + 1.2 = _____

3)

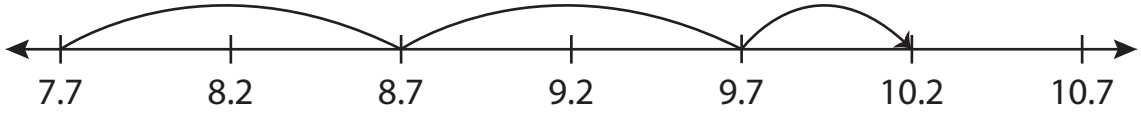

7.7 + 2.5 = _____

4)

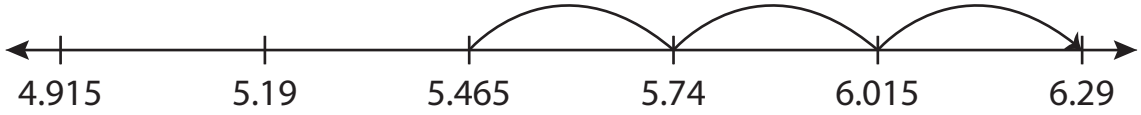

5.465 + 0.825 = _____

5)

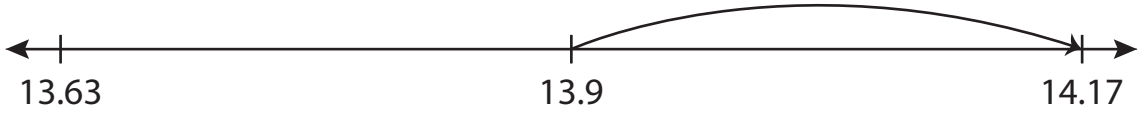

13.9 + 0.27 = _____

6)

2.085 + 0.51 = _____