Area of Rectilinear Figures

Find the area of each figure.

1)

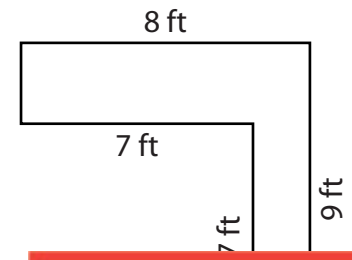

2)

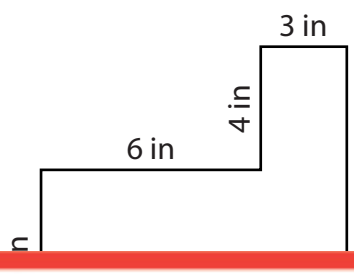

3)

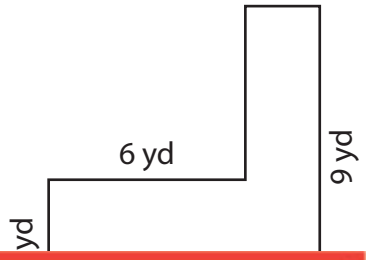

Preview

Become a member to unlock unrestricted access to both printable and online worksheets.

www.tutoringhour.com

A

4)

9 yd

Area = _____ Area = _____ Area = _____

7) A farmer has a rectangular barn attached to a rectangular storage shed in an L-shape. The barn measures 9 yards by 7 yards, and the storage shed measures 8 yards by 4 yards. What is the total area of the barn and shed?

_____